Ten-Frame Number Bonds to 10

Hollow circles show the dots to add. Boxes show the missing parts.

LOOK TOGETHER

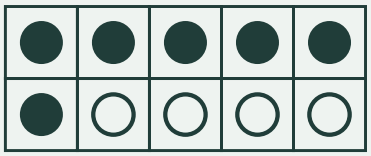

6 dots + 4 empty spaces = 10

Draw a circle in each empty space.

Six and four are parts of ten.

1 Count. 2 Draw the missing dots. 3 Complete the sentence.

1. **MAKE TEN**

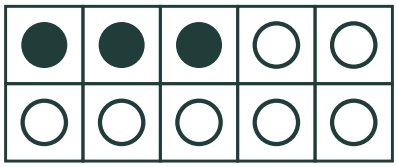

3 + [7] = 10

2. **MAKE TEN**

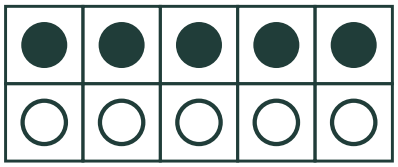

5 + [5] = 10

3. **MAKE TEN**

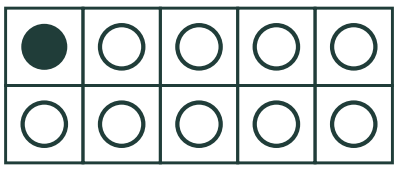

1 + [9] = 10

4. **MAKE TEN**



8 + [2] = 10

Talk together: how do the empty spaces help you find the missing part?

Ten-Frame Number Bonds to 10

Hollow circles show the dots to add. Boxes show the missing parts.

Find the missing part

Fill each ten-frame. The missing number can come first or second.

5. MAKE TEN



1 + 9 = 10

6. MAKE TEN

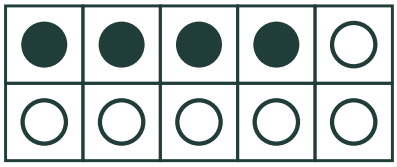

4 + **6** = 10

7. MAKE TEN



3 + 7 = 10

8. MAKE TEN

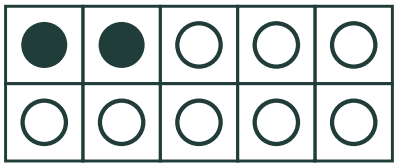

2 + **8** = 10

9. MAKE TEN

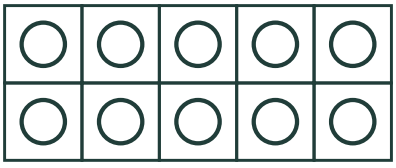

10 + 0 = 10

10. MAKE TEN



10 + **0** = 10

Zero is a number too: an empty frame needs ten dots; a full frame needs none.