Teen Numbers: One Ten and Some Ones

A long rod is ten. Each separate square is one.

LOOK TOGETHER

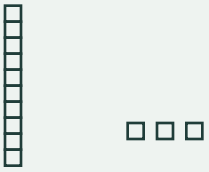

13 is 1 ten and 3 ones.

10 + 3 = 13

A ten is a group of ten equal units.

Count the ten first, then the extra ones. Fill in all three boxes.

1. READ THE MODEL

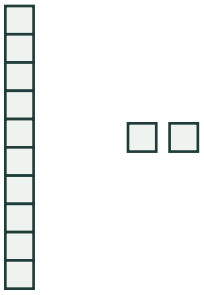

☐ ten ☐ ones = ☐

2. READ THE MODEL

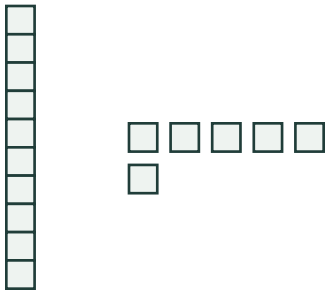

☐ ten ☐ ones = ☐

3. READ THE MODEL

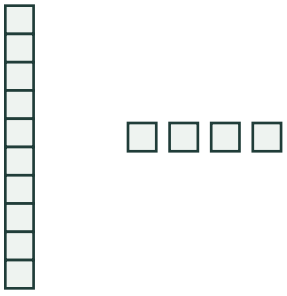

☐ ten ☐ ones = ☐

4. READ THE MODEL

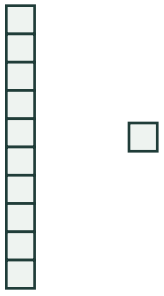

☐ ten ☐ ones = ☐

Say the number aloud: one ten and some ones. Count on from ten to check.

Teen Numbers: One Ten and Some Ones

Make each number using one group of ten and some separate ones.

Build a teen number

Shade the whole ten rod. Draw the extra ones in the empty area.

5. **MAKE 17**



10 + ☐ = 17

☐ ten ☐ ones = 17

6. **MAKE 15**



10 + ☐ = 15

☐ ten ☐ ones = 15

7. **MAKE 19**



10 + ☐ = 19

☐ ten ☐ ones = 19

8. **MAKE 18**



10 + ☐ = 18

☐ ten ☐ ones = 18

Adult check: accept any clear arrangement of the correct number of equal ones.