Teen Numbers: One Ten and Some Ones

Each model shows one ten and the correct number of separate ones.

LOOK TOGETHER

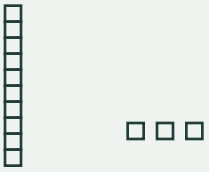

13 is 1 ten and 3 ones.

10 + 3 = 13

A ten is a group of ten equal units.

Count the ten first, then the extra ones. Fill in all three boxes.

1. **READ THE MODEL**

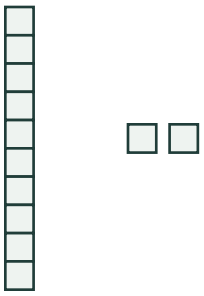

1 ten **2** ones = **12**

2. **READ THE MODEL**

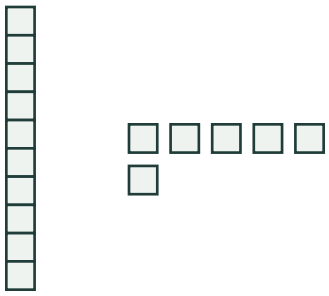

1 ten **6** ones = **16**

3. **READ THE MODEL**

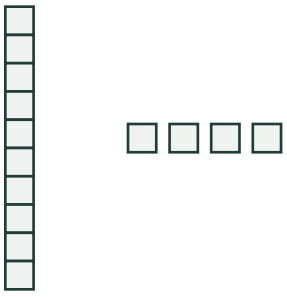

1 ten **4** ones = **14**

4. **READ THE MODEL**

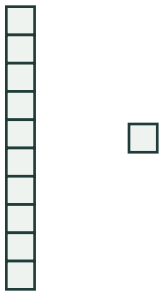

1 ten **1** ones = **11**

Say the number aloud: one ten and some ones. Count on from ten to check.

Teen Numbers: One Ten and Some Ones

Each model shows one ten and the correct number of separate ones.

Build a teen number

Shade the whole ten rod. Draw the extra ones in the empty area.

5. **MAKE 17**

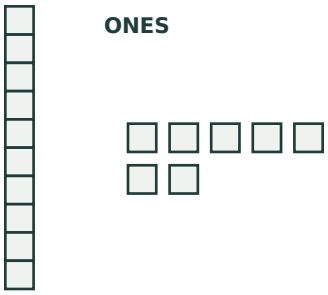

10 + **7** = 17

1 ten **7** ones = **17**

6. **MAKE 15**

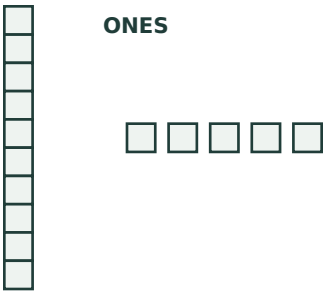

10 + **5** = 15

1 ten **5** ones = **15**

7. **MAKE 19**

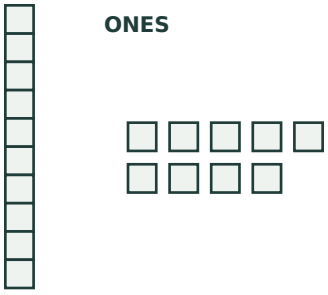

10 + **9** = 19

1 ten **9** ones = **19**

8. **MAKE 18**

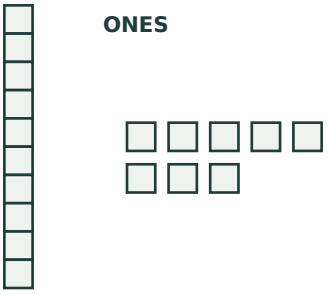

10 + **8** = 18

1 ten **8** ones = **18**

Adult check: accept any clear arrangement of the correct number of equal ones.