Share into Equal Groups

Count one group. Check that all the groups have the same number.

LOOK TOGETHER



8 counters shared into 2 equal groups.

Each group gets 4 counters.

Give one to each group in turn.

1. 12 counters shared equally into 3 groups.



Each group gets ☐ counters.

2. 10 counters shared equally into 2 groups.



Each group gets ☐ counters.

3. 15 counters shared equally into 5 groups.

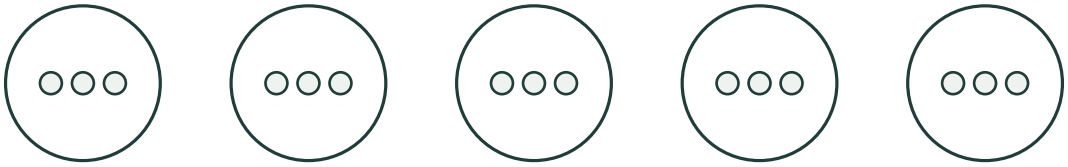

Each group gets ☐ counters.

Adult check: accept any clear arrangement with the correct equal number in every group.

Share into Equal Groups

Draw the counters to share each total equally, then complete the sentence.

Draw to share fairly

Draw all the counters inside the groups. Every group must get the same number.

4. 12 counters shared equally into 4 groups.



Each group gets ☐ counters.

5. 18 counters shared equally into 3 groups.



Each group gets ☐ counters.

6. 16 counters shared equally into 4 groups.



Each group gets ☐ counters.

Adult check: accept any clear arrangement with the correct equal number in every group.