Right Angles in Turned Shapes

Work at your own pace. A separate guide is available.

A right angle is a square corner. Count the right angles in each pictured shape, even when the shape is turned.

A



Right angles: _____

B



Right angles: _____

C



Right angles: _____

D



Right angles: _____

E



Right angles: _____

F

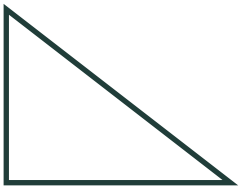

Right angles: _____