Read Thermometers in Five-Degree Steps

Read equal intervals on a Celsius scale.

Each interval is 5 degrees Celsius. Read the top of the dark column. Write each temperature, then compare the readings.

Example: five intervals above 0 = 25 degrees Celsius

A



_____ degrees C

B

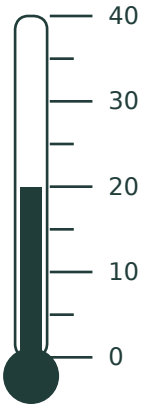

_____ degrees C

C



_____ degrees C

D



_____ degrees C

E



_____ degrees C

F

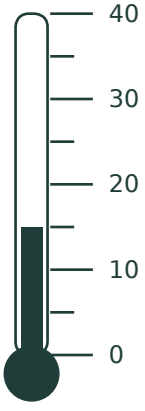

_____ degrees C

Which is warmest? _____

How much warmer is C than D? _____ degrees C