Read Mass Scales in 50 g Steps

Work at your own pace. A separate guide is available.

Each small interval represents 50 g. Write the reading at each arrow. These diagrams show mass, not a life-size ruler.

A

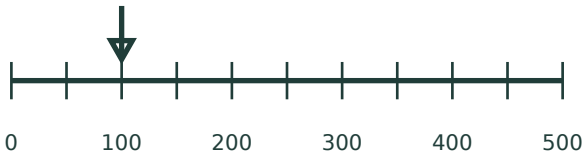

Reading: _____ g

B

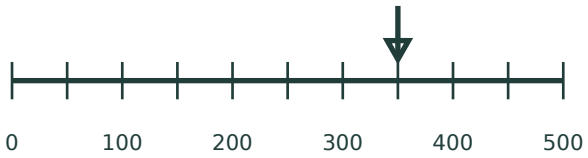

Reading: _____ g

C

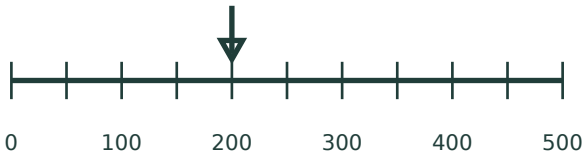

Reading: _____ g

D

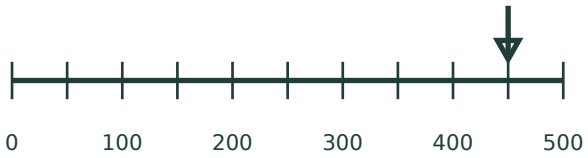

Reading: _____ g

E



Reading: _____ g

F

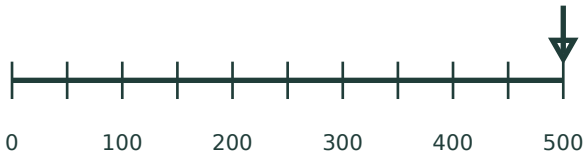

Reading: _____ g

Greatest: ____ D minus A: _____ g