Perimeter: Count the Outside Edges

Trace the boundary once, then check your count.

Each short square edge is 1 unit. Count the outside edges. Do not count the pale lines inside a shape.



Example: 3 + 1 + 3 + 1 = 8 units

A



Perimeter: _____ units

B



Perimeter: _____ units

C

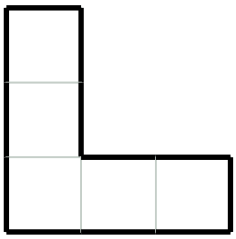

Perimeter: _____ units

D

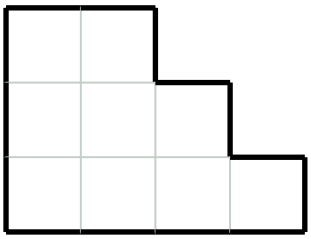

Perimeter: _____ units

Which two shapes have the same perimeter? _____ and _____