# Arrays and Related Multiplication and Division Facts

Work at your own pace. A separate guide is available.

Count rows and columns in each array. Write two multiplication facts and two division facts using the same three numbers.

**A**



___ × ___ = ___

___ × ___ = ___

___ ÷ ___ = ___

___ ÷ ___ = ___

**B**



___ × ___ = ___

___ × ___ = ___

___ ÷ ___ = ___

___ ÷ ___ = ___

**C**



___ × ___ = ___

___ × ___ = ___

___ ÷ ___ = ___

___ ÷ ___ = ___

**D**



___ × ___ = ___

___ × ___ = ___

___ ÷ ___ = ___

___ ÷ ___ = ___