Measure Lengths in Centimetres

Use the spaces between the marks to measure each length.

Read the length of each object. The dotted guides show its ends. Write a number in centimetres (cm).

Print at 100%. Ask an adult to check the 5 cm line below first.

1. Pencil

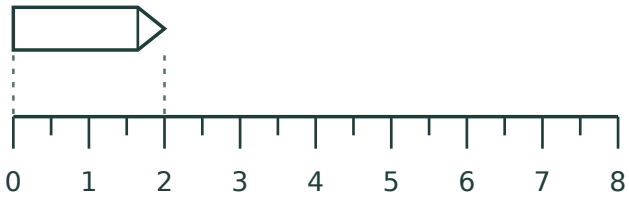

____ cm

2. Ribbon

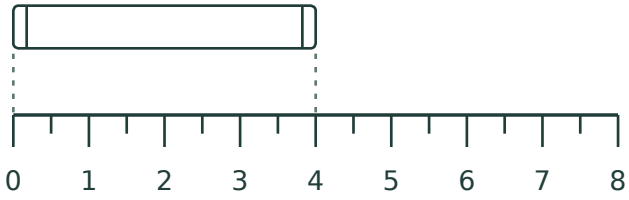

____ cm

3. Stem

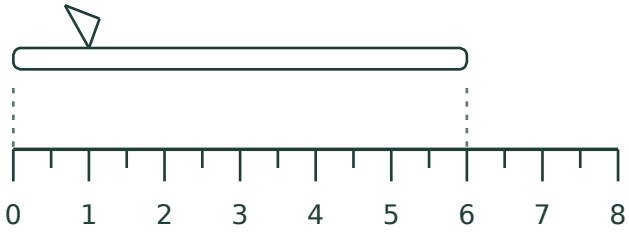

____ cm

4. Shifted ribbon

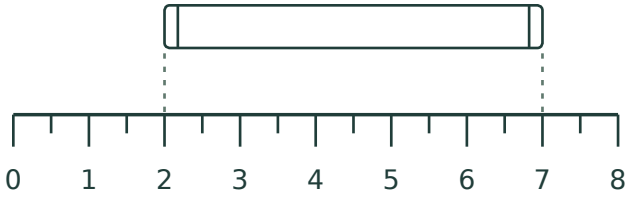

____ cm

Adult scale check: 5 cm



Why is number 4 not 7 cm long?