Fractions of Sets: Share, Then Count

Work at your own pace. A separate guide is available.

Split the dots into the stated number of equal groups. Ring one group and write how many dots are in it.

A 1/2 of 8



One group = _____ dots

B 1/3 of 12



One group = _____ dots

C 1/4 of 16



One group = _____ dots

D 1/2 of 10



One group = _____ dots

E 1/3 of 15



One group = _____ dots

F 1/4 of 20



One group = _____ dots