Balance Scales: Heavier, Lighter or Equal

Look at the pans before choosing an answer.

On an equal-arm balance, the heavier parcel is lower. Level pans show equal mass. Read the balances; do not guess from parcel size.

1.

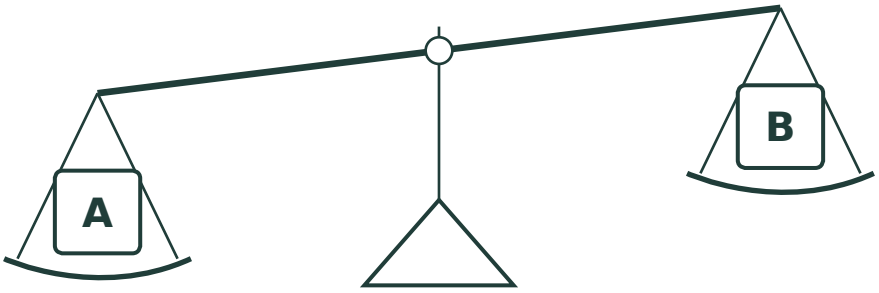

Circle the heavier parcel: A B equal mass

2.

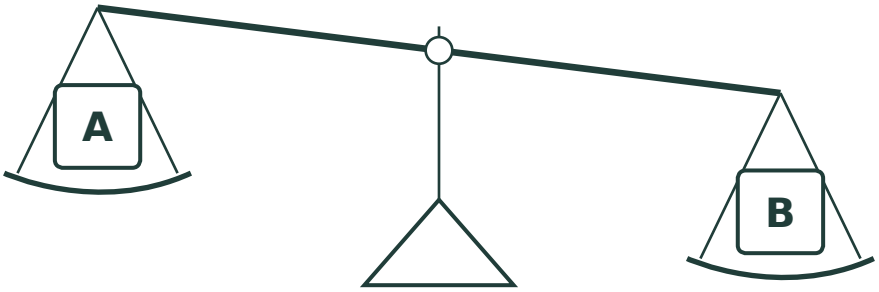

Circle the heavier parcel: A B equal mass

3.

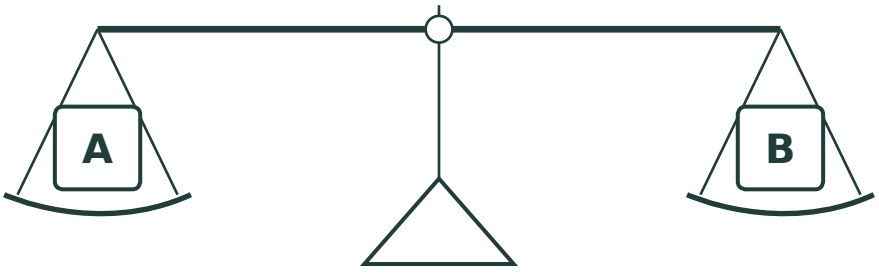

Circle the heavier parcel: A B equal mass

On balance 1, which parcel is lighter? _____