Area: Count the Covered Squares

Measure the space covered, one square at a time.

Each small square is 1 square unit. Count the covered squares inside each shape.

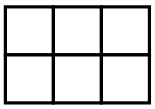

Example: 3 + 3 = 6 square units

A



Area: ____ square units

B

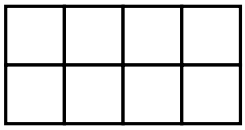

Area: ____ square units

C

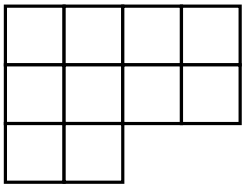

Area: ____ square units

D



Area: ____ square units

Which two shapes cover the same area? ____ and ____

Shade exactly 6 whole squares. Make one connected shape.



Check: I shaded
6 squares altogether.